EXERCICE 7

Pour chaque figure une fraction de la figure est coloriée ; indiquer laquelle.

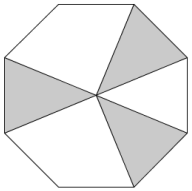



EXERCICE 8

Tracer un segment [AB] de longueur 14 cm puis tracer 2 segments [CD] et [EF] tels que CD = $\frac{2}{7}$ AB et EF = $\frac{9}{7}$ AB.

EXERCICE 9

Calculer cinq huitièmes de 32.

Exercice 10

Dans chaque cas, ou bien indiquez la fraction hachurée de la figure ou bien placez dans le rond la fraction correspondant au point de la graduation.

1)

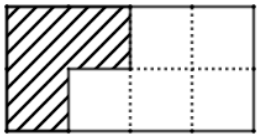

2)

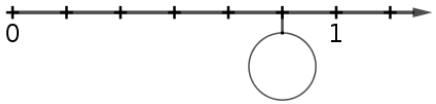

3)

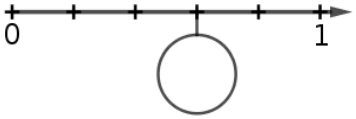

4)

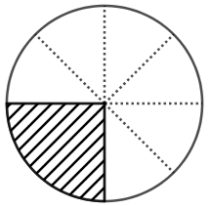

5)

6)

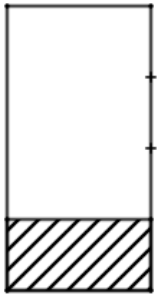

7)

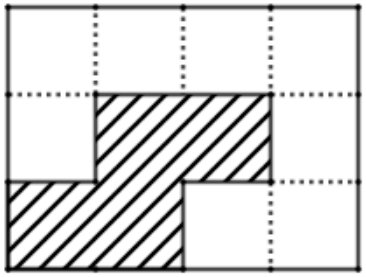

8)

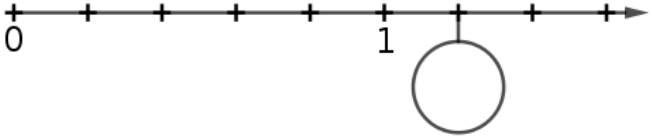

9)

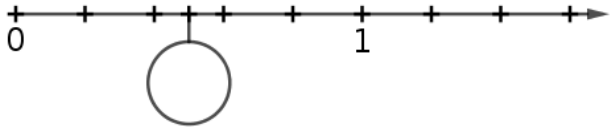
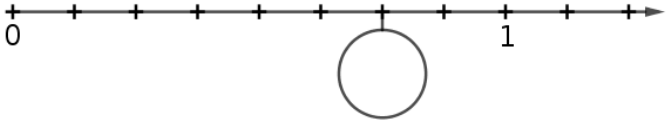
10)